Standard: 3MG1.1
Choose the appropriate tools and units (metric and U.S.) and estimate and measure the length, liquid volume, and weight/mass of given objects—Exercise 2

1. Which units of measure would be the **MOST** appropriate to determine the weight of this book?



A inches
B pounds
C quarts
D yards

2. Which units of measure would be the **MOST** appropriate to determine the length of a swimming pool?

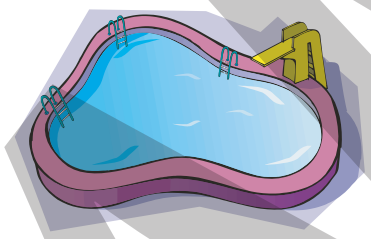

A gallons
B inches
C pounds
D yards

3. Which units of measure would be the **MOST** appropriate to determine the weight of a lemon?

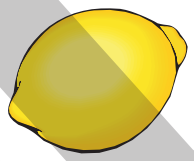

A cups
B inches
C ounces
D yards

4. Which units of measure would be the **MOST** appropriate to determine the amount of cooking oil for a cake recipe?

A cups
B feet
C inches
D pounds

5. Which units of measure would be the **MOST** appropriate to determine the weight of this puppy?

A feet
B inches
C ounces
D pints

SAMPLE

This page may not be reproduced.

Standard: 3MG2.4
Identify right angles in geometric figures or in appropriate objects and determine whether other angles are greater or less than a right angle—Exercise 2

1. Look at the angles marked on the picture of a frame below.

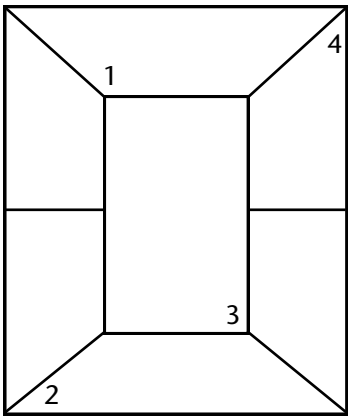

Which angle is greater than 90˚?

A angle 1
B angle 2
C angle 3
D angle 4

2. Look at the angles marked on the drawing below.

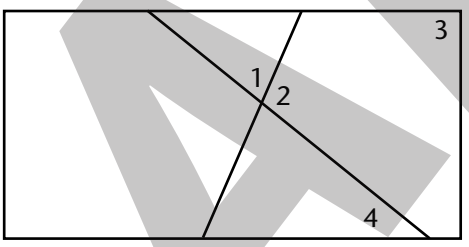

Which angle is a right angle?

A angle 1
B angle 2
C angle 3
D angle 4

3. Look at the angles marked on the picture of a window below.

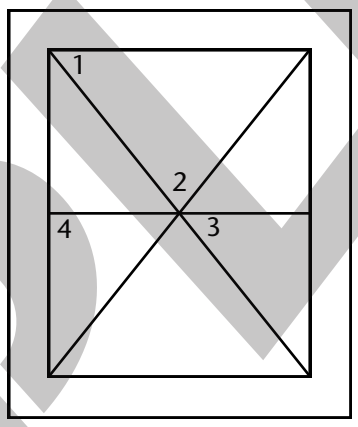

Which angle is a right angle?

A angle 1
B angle 2
C angle 3
D angle 4

4. Look at the angles marked on the drawing below.

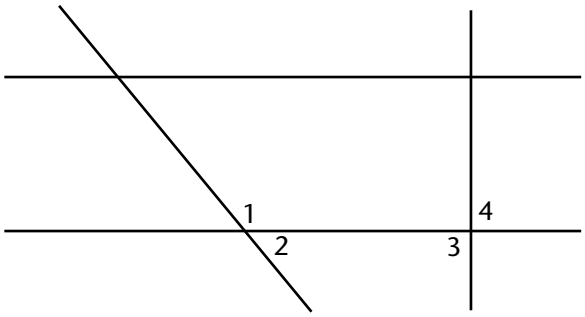

Which angle is less than 90˚?

A angle 1
B angle 2
C angle 3
D angle 4

This page may not be reproduced.

SAMPLE

 © ECS Learning Systems, Inc.

Standard: 3PS1.3
Summarize and display the results of probability experiments in a clear and organized way—Exercise 1

1. Each of 2 game tokens is marked with a square on one side and a triangle on the other.

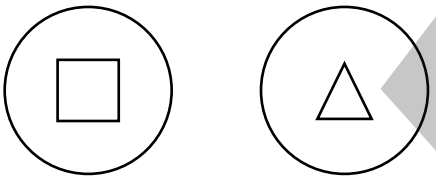

Gilda tossed the tokens 12 times and recorded the results. The results are shown on the tally chart below.

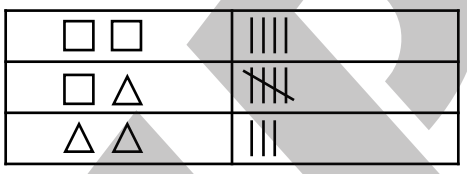

Which graph shows these results?

A

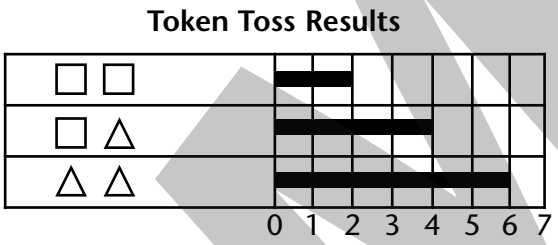

B

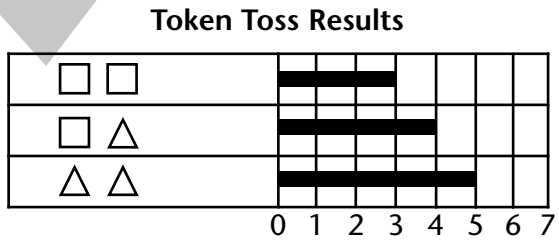

C

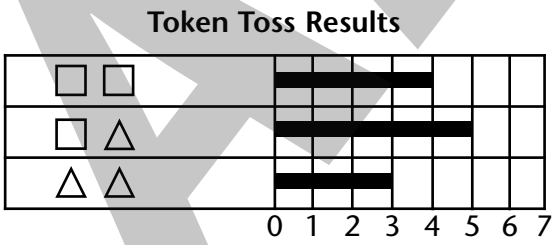

D

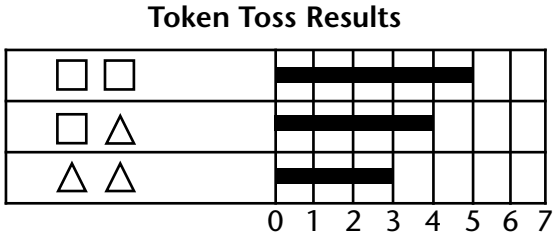

This page may not be reproduced.

SAMPLE

 © ECS Learning Systems, Inc.